Name: ______________________ Date: ______/_______/________

Directions: Write the time from the analog clock (the one with the minute and hour hands) onto the digital clock. Remember a digital clock is *hour* **:** *minutes*









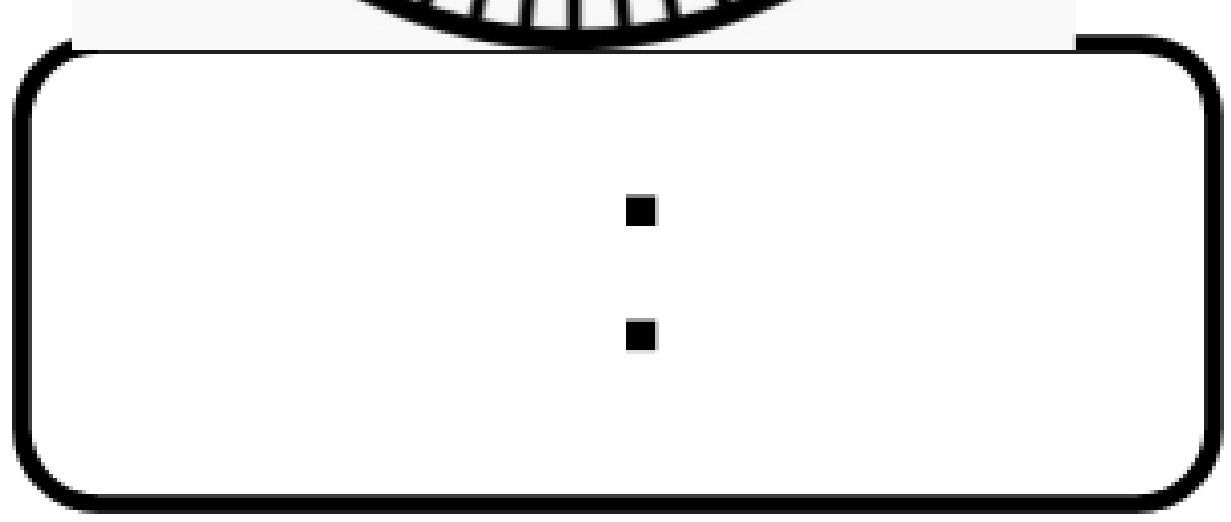

12
1
2
3
4
5
6
7
8
9
10
11

:

12
1
2
3
4
5
6
7
8
9
10
11

:

12
1
2
3
4
5
6
7
8
9
10
11

:

12
1
2
3
4
5
6
7
8
9
10
11

: